GEOMETRÍA

Quinto Grado de Primaria

Operaciones con Segmentos

PRACTIQUEMOS

1. **Sobre una recta se dan los puntos consecutivos A, B, C, D, de tal manera que : AB = 8cm., AC = 18 cm., AD=27. Calcular BC + CD**

2. **De la figura, calcular: x**

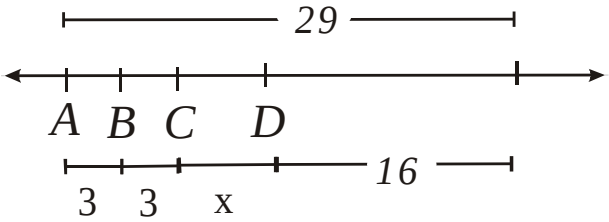

3. **De la siguiente figura, calcular el valor de x.**

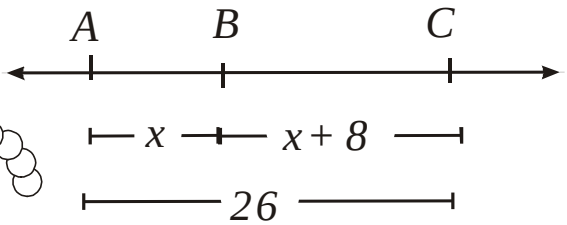





4. Del gráfico, hallar: CD. **Si** **AB = BC = 5**
AD = 84

5. Del gráfico, calcular EF.

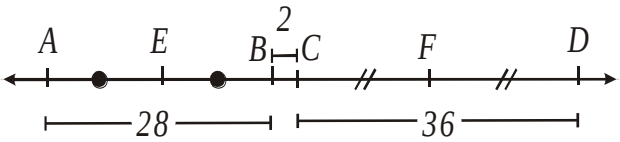

6. De la figura, calcular el segmento $\overline{AD}$. Si "E" punto medio de $\overline{AB}$, "F" punto medio de $\overline{CD}$

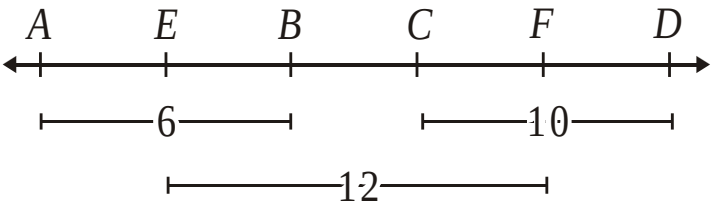

7. De la figura, hallar AE. Si : AB = BC ; EC = CD = 2

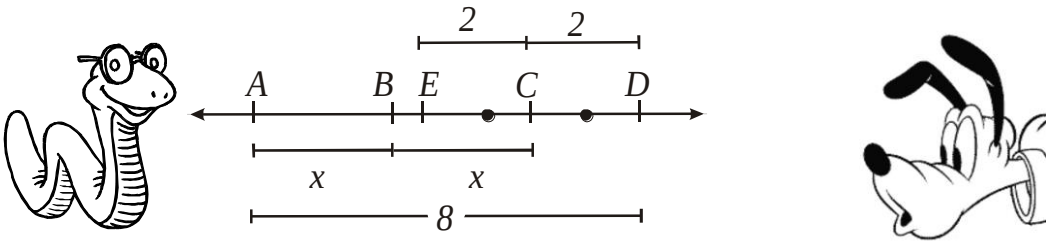

8. Del gráfico, calcular BC.

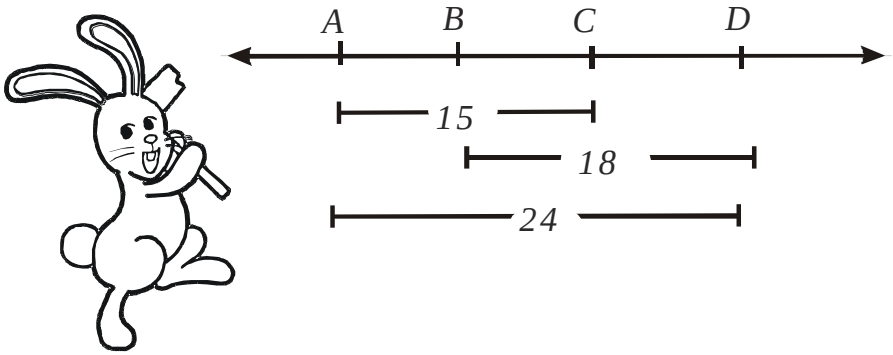

9. Se tienen los puntos consecutivos A, B, C, D, siendo B punto medio de $\overline{AC}$. Calcular AB.

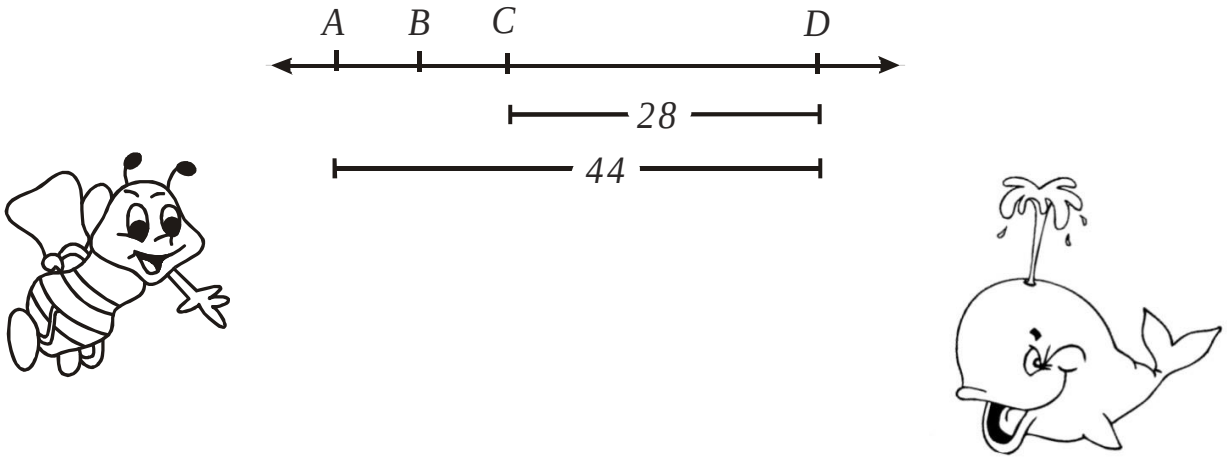

10. Se tiene los puntos colineales A, B, C, D y E dispuestos de la siguiente manera. Hallar K



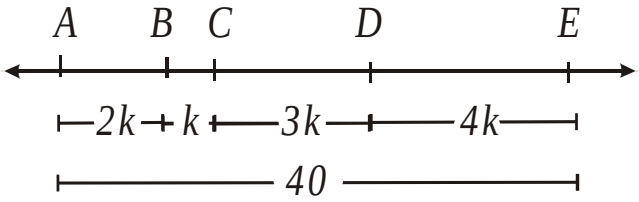



11. Del gráfico, hallar BC

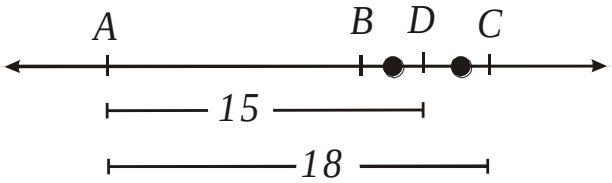

12. De la figura, calcular BE

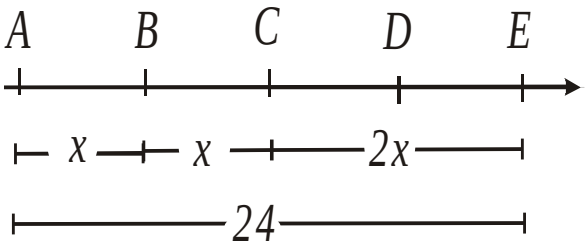



TRABAJEMOS EN CASA

1. Del gráfico, hallar AC

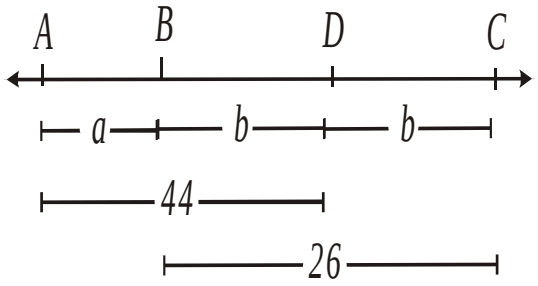

2. De la figura, calcular PC.

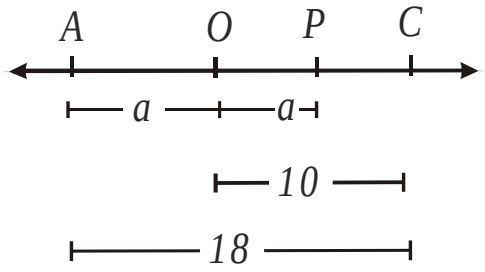

3. Del gráfico adjunto, calcular ME.

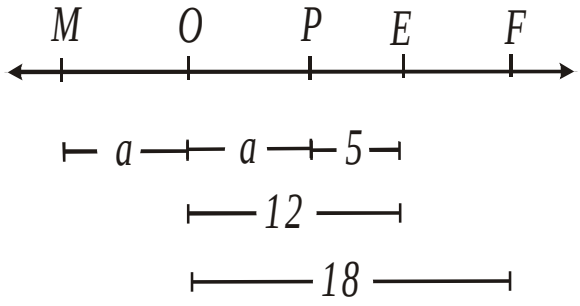

4. *Del gráfico, calcular EF*

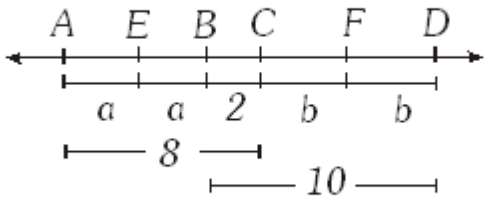

5. *Del gráfico, calcular EF*

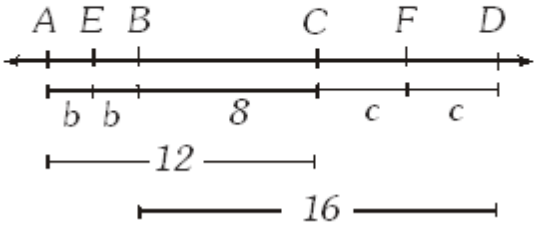
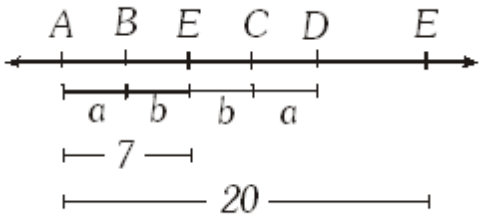
6. *Del gráfico, hallar DE.*